Name: _____

Copy each letter to the right of the letter.

Think of a word that starts with the letter o. Write the word in cursive two times.

Word clues: Search through the words to help with the missing letters in the next section!

diamondsailboatsongoff

roderosefoolishfountain

togetherstorefrozepound

Now fill in the missing letters.

s mg

ff

und

se

t g t e

ailb a

st

f is

f e

untai

Name: _____

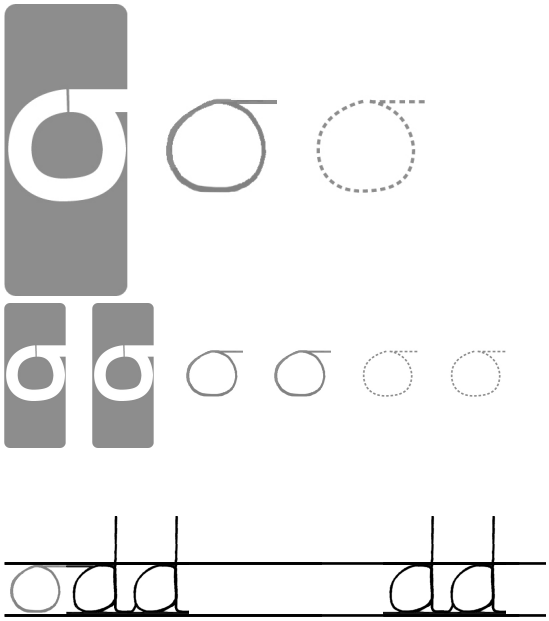

Circle the odd numbers.

33	22	47
44	100	59
54	50	132
77	25	69

Write an even number with a five in the thousands place.

_____

Complete the pattern.

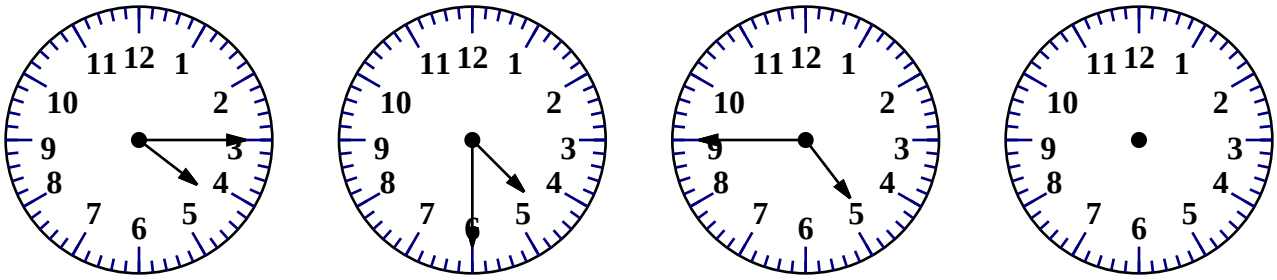

4:15 pm | 4:30 pm | _____ pm | _____ pm

43 + 3 = _____



Use each of the letters to fill in the grid.
Write two words.

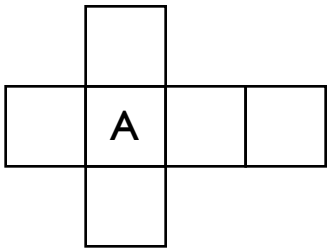

K T F

B C

word root **retro** can mean **backward** **retrospect, retrospection, retrospective**

Name: _____


oysters
oysters
ysters
btain
btain
tain
model
model
odel
unload
unload
nload
ccupy
ccupy
cupy

Name: _____

Copy each letter to the right of the letter.

w w w w

Think of a word that starts with the letter w. Write the word in cursive two times.

Word clues: Search through the words to help with the missing letters in the next section!

reward wish tomorrow

shadow known strawberry

wait sweet wave watch

Now fill in the missing letters.

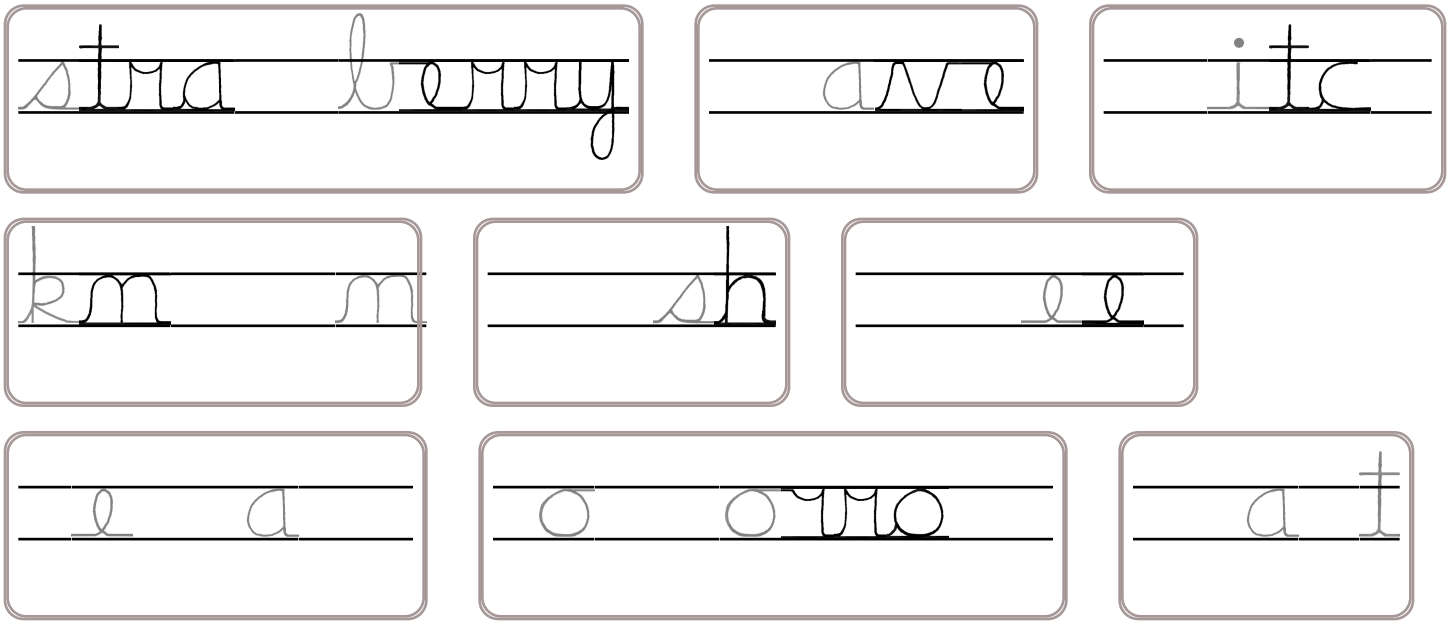

Name: _____



What number is ten thousand more than 3,782?

_____

$$\begin{array}{r} 93 \\ -\ 63 \\ \hline \end{array}$$

Can you draw ONE line going through ALL the circles? Your line can go left, right, up, or down. It cannot go diagonally. Your line cannot cross over any part of the line you have already drawn.
You MUST TURN in a BLACK circle. Do NOT TURN in a WHITE circle.

The first puzzle shows a correct line going through all the circles.

Example:

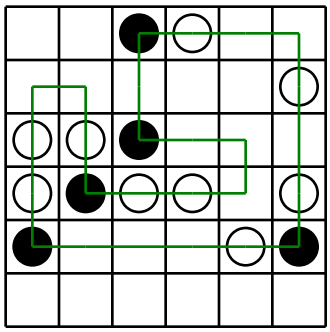

Finish the line:

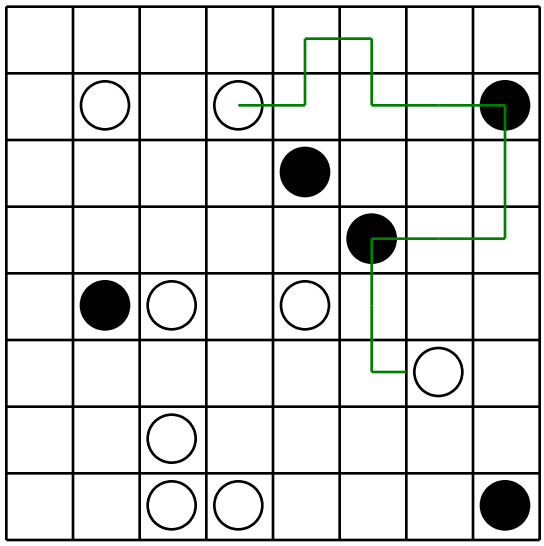

$$\begin{array}{r} 27 \\ +\ 88 \\ \hline \end{array} \qquad \begin{array}{r} 38 \\ +\ 71 \\ \hline \end{array} \qquad \begin{array}{r} 11 \\ +\ 13 \\ \hline \end{array} \qquad \begin{array}{r} 63 \\ +\ 52 \\ \hline \end{array}$$

$$\begin{array}{r} 73 \\ -\ 69 \\ \hline \end{array} \qquad \begin{array}{r} 52 \\ -\ 43 \\ \hline \end{array}$$

Name: _____


oysters
oysters
ysters
btain
btain
tain
model
model
odel
unload
unload
nload
ccupy
ccupy
cupy

Name: _____

Copy each letter to the right of the letter.

b b b b b b b

Think of a word that starts with the letter b. Write the word in cursive two times.

Word clues: Search through the words to help with the missing letters in the next section!

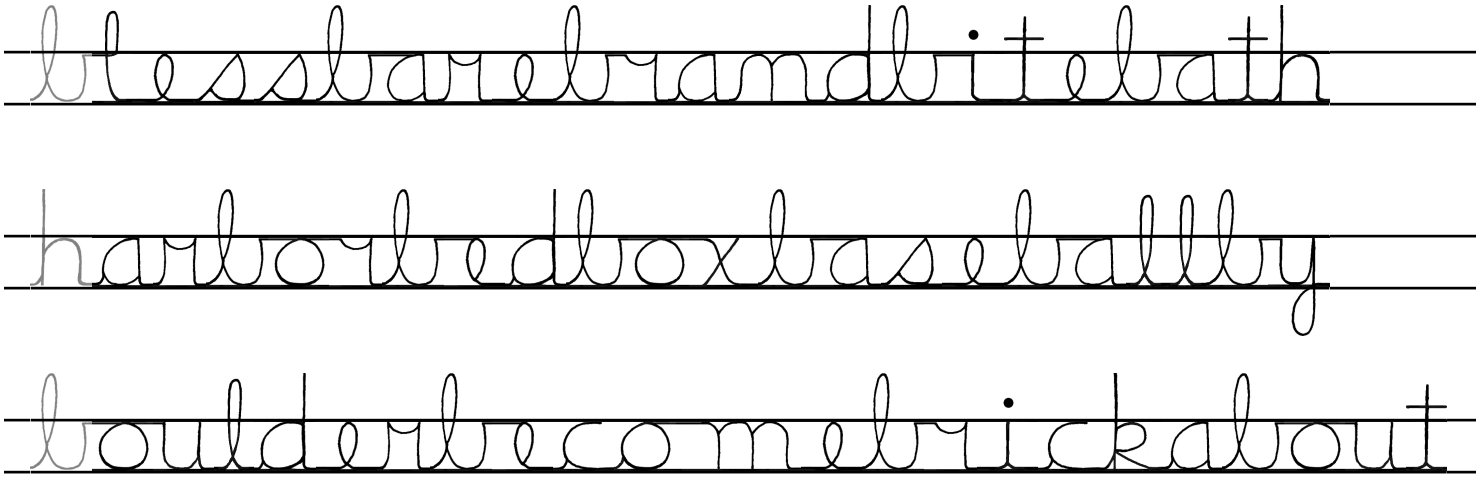

Now fill in the missing letters.

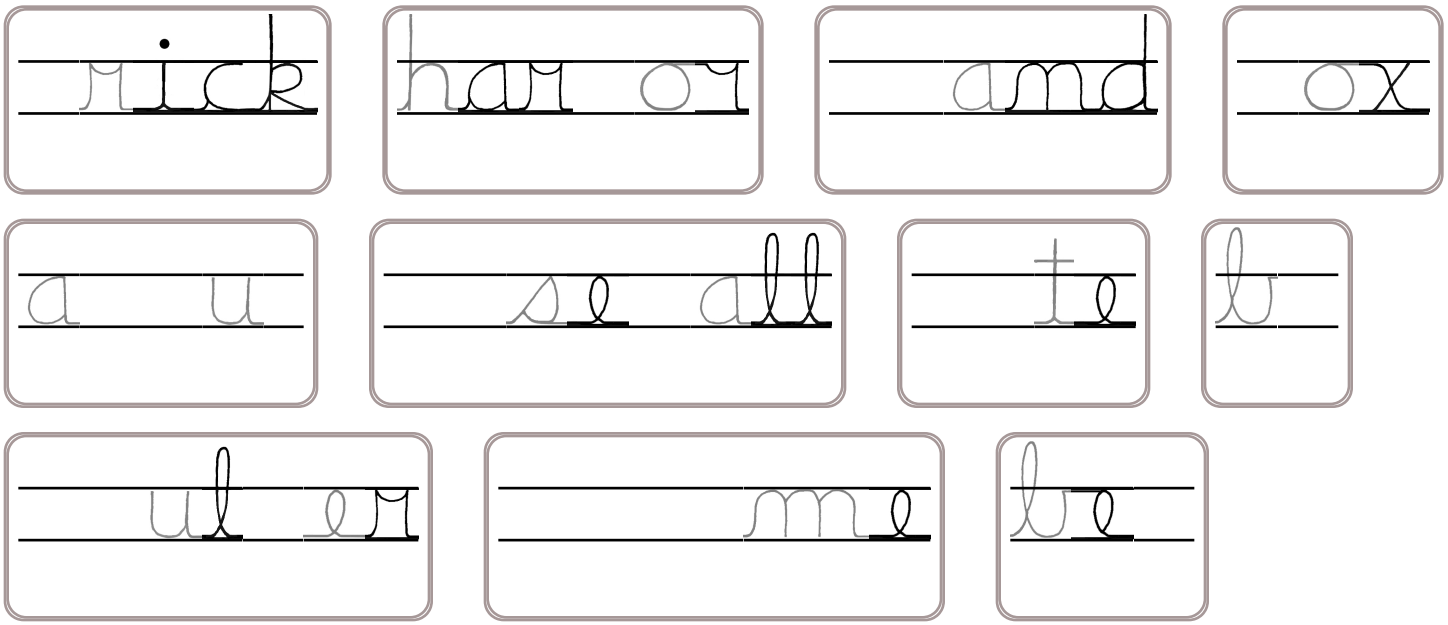

Name: _____

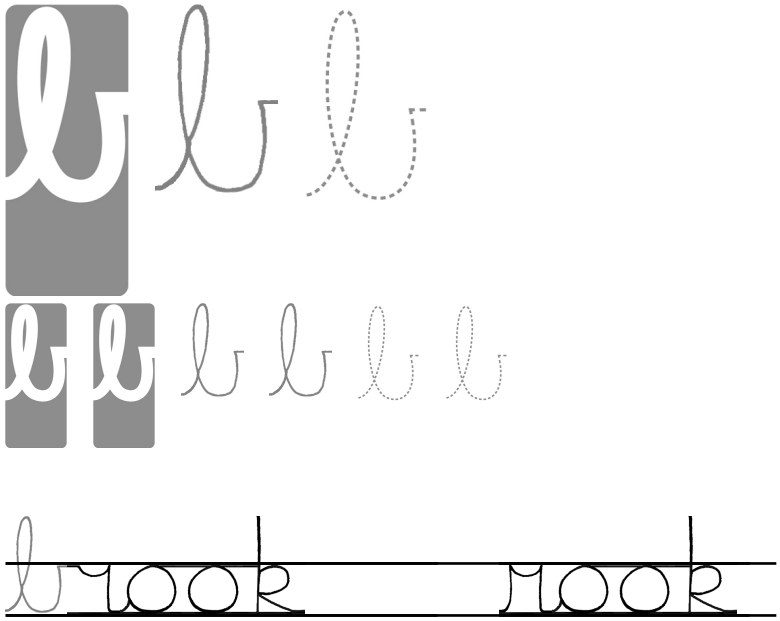

Records show there were 342 people in the park on the first day of spring. There were 190 children. How many adults were in the park?

What is a good estimate for 549 times 8?

_____

What are 10 tens equal to?

_____

One side of a square measures eleven centimeters. What is the area of this square?

_____

$7\overline{)21}$

List the first five multiples of 11.

_____ _____ _____ _____ _____

$$\begin{array}{r} 29 \\ +\ 46 \\ \hline \end{array}$$

Circle the largest number.

658	694	681
603	649	660

Which is larger, $\frac{2}{6}$ or $\frac{4}{6}$?

_____

Circle the correctly spelled words.

operate, uppset, floteing, conflict

Circle the answer that best completes the sentence.

(May/Can) you go to the baseball game with my family this weekend?

- ○ skreenn
- ○ screen
- ○ sreen
- ○ skrean

Which is longer: two feet or twenty-seven inches?

_____

2 x 9 = _____

$$\begin{array}{r} 75 \\ +\ 77 \\ \hline \end{array}$$



word root **dur** can mean **lasting or to last** **durable, duration**

Name: _____


oysters
oysters
ysters
btain
btain
tain
model
model
odel
unload
unload
nload
ccupy
ccupy
cupy

Name: _____

Copy each letter to the right of the letter.

Think of a word that starts with the letter v. Write the word in cursive two times.

Word clues: Search through the words to help with the missing letters in the next section!

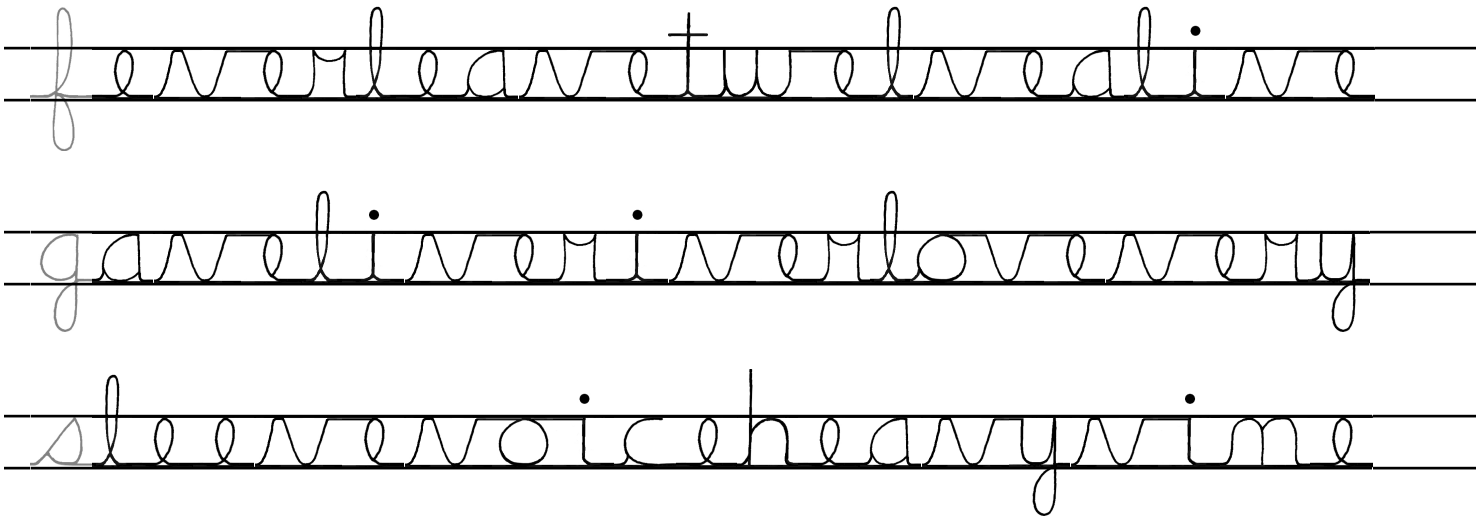

Now fill in the missing letters.

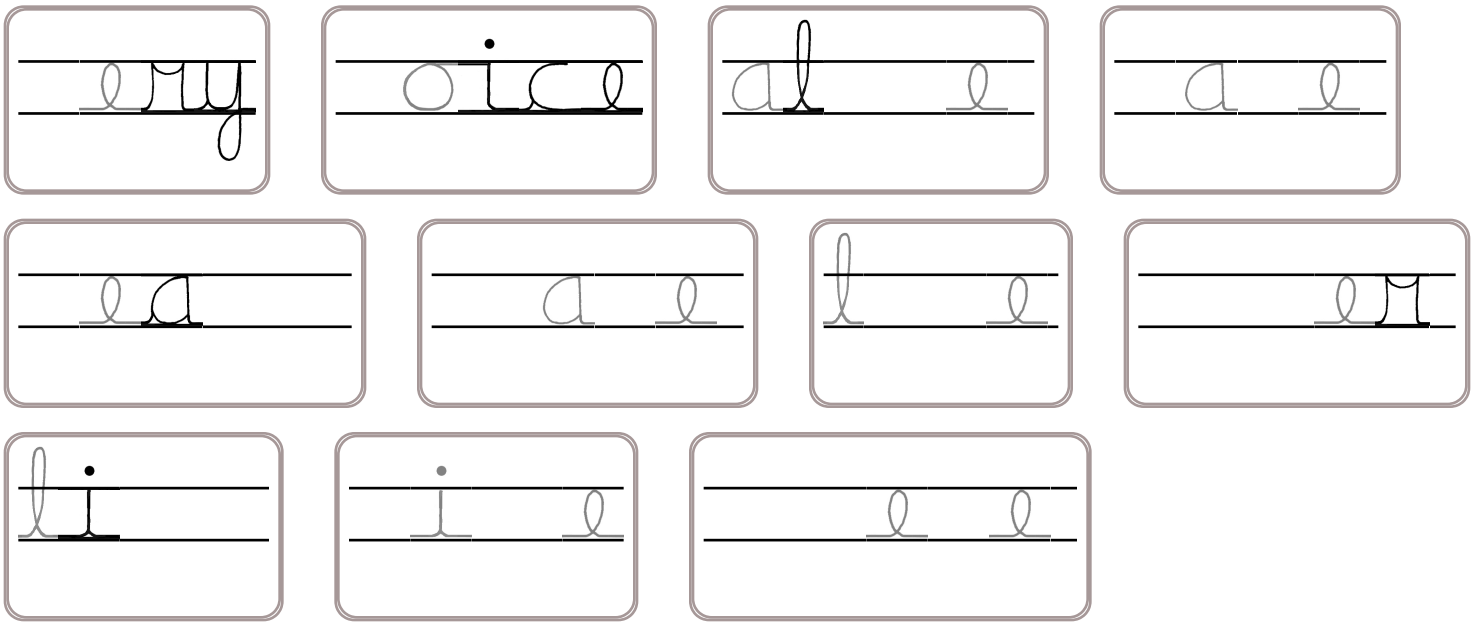

Name: _____

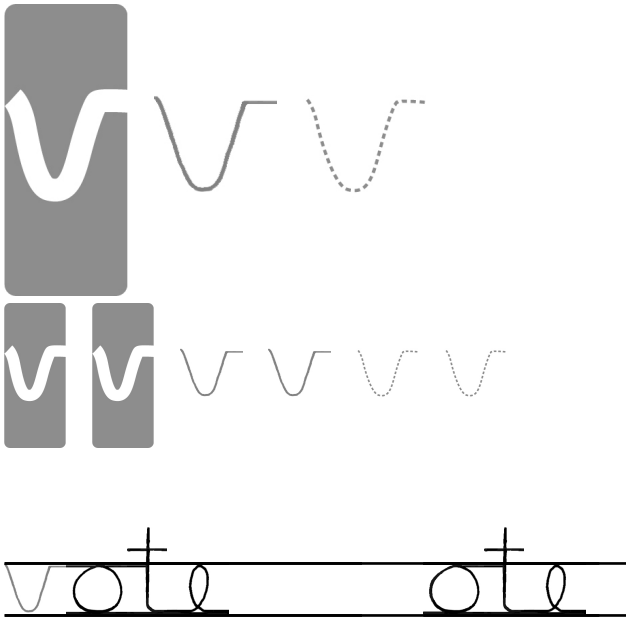

Jacob made his own kite. He spent $5.47 on his kite. Peter bought his kite at the store. It cost $9.99. How much more did Peter's kite cost than Jacob's kite?

What are 22 tens equal to?

_____

Color $\frac{52}{100}$.



Is 53 closer to 50 or 60?

_____

$$\begin{array}{r} 3 \\ 4 \\ +\ 8 \\ \hline \end{array} \qquad \begin{array}{r} 9 \\ 3 \\ +\ 3 \\ \hline \end{array}$$

What is the range of these numbers?

20, 17, 24, 29, 27, 22, 17

_____

Calculate the sum of 18, 21, and 24.

_____

$$\begin{array}{r} 26 \\ -\ 23 \\ \hline \end{array}$$

Locate where to put the number 490,000 and label the point M.

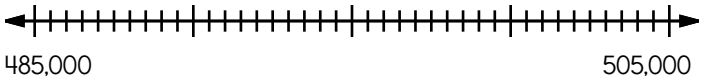

What is the value of the BIG digit?

344,1**4**9,762

_____

It is 84 degrees Fahrenheit outside. What would you wear if you are going outside?

_____

How many seconds are in one minute?

_____

$$\begin{array}{r} 85 \\ -\ 48 \\ \hline \end{array}$$

Name: _____


oysters
oysters
ysters
btain
btain
tain
model
model
odel
unload
unload
nload
ccupy
ccupy
cupy

Where can I get more of this great stuff?
More math!
More spelling!
It's NO PREP at edHelper.
CLASS RULES
A E I O U Y
edHelper.com!
only $19.99 per year
More history!
Things for the classroom!
1 2 3
More science!
More puzzles!
New ideas!

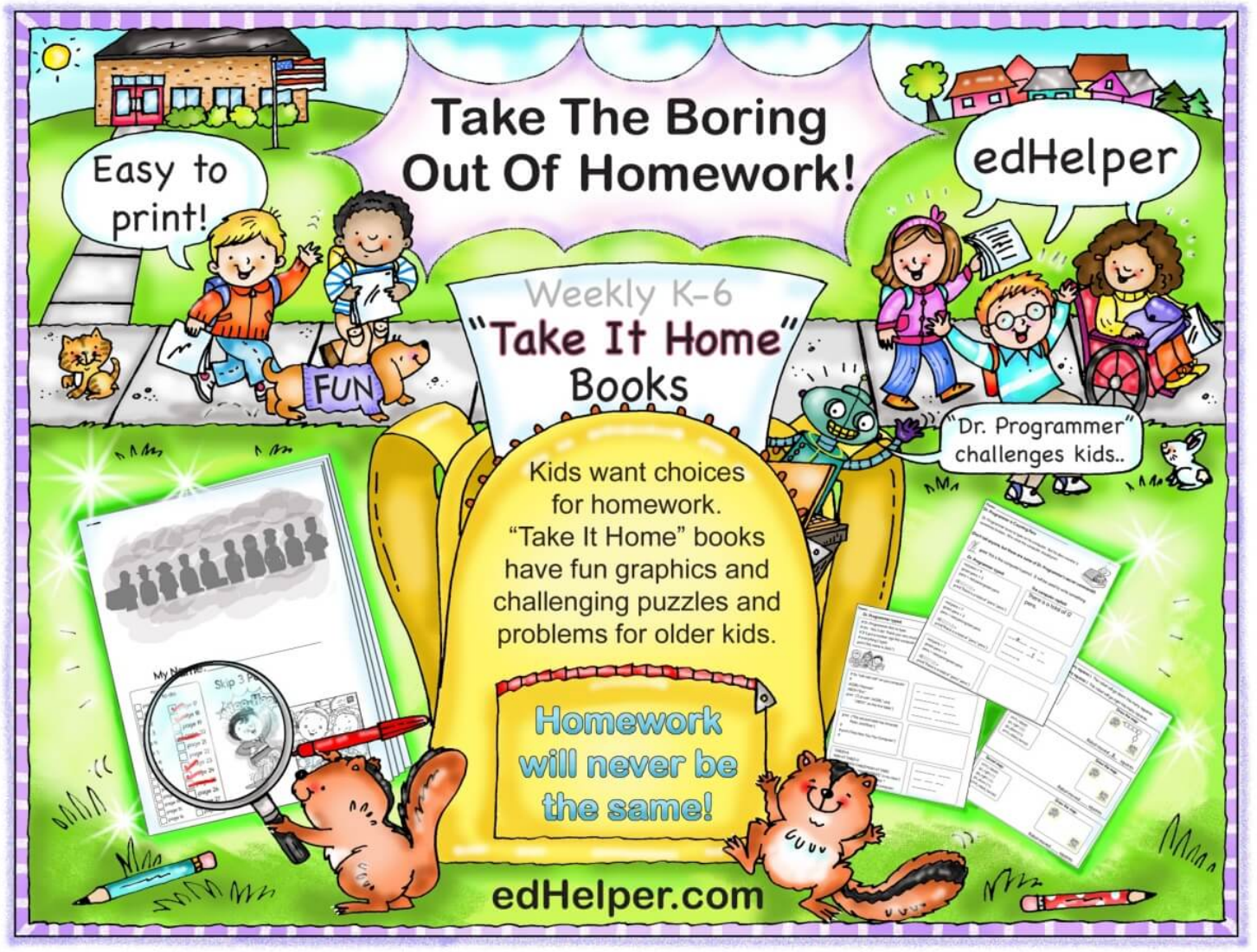
Take The Boring Out Of Homework!
Easy to print!
edHelper
Weekly K-6
"Take It Home" Books
FUN
"Dr. Programmer" challenges kids..
Kids want choices for homework. "Take It Home" books have fun graphics and challenging puzzles and problems for older kids.
Homework will never be the same!
edHelper.com