Name: _____

Tally marks help organize information in groups that total 5. Use them to record the kinds of bugs in the garden.

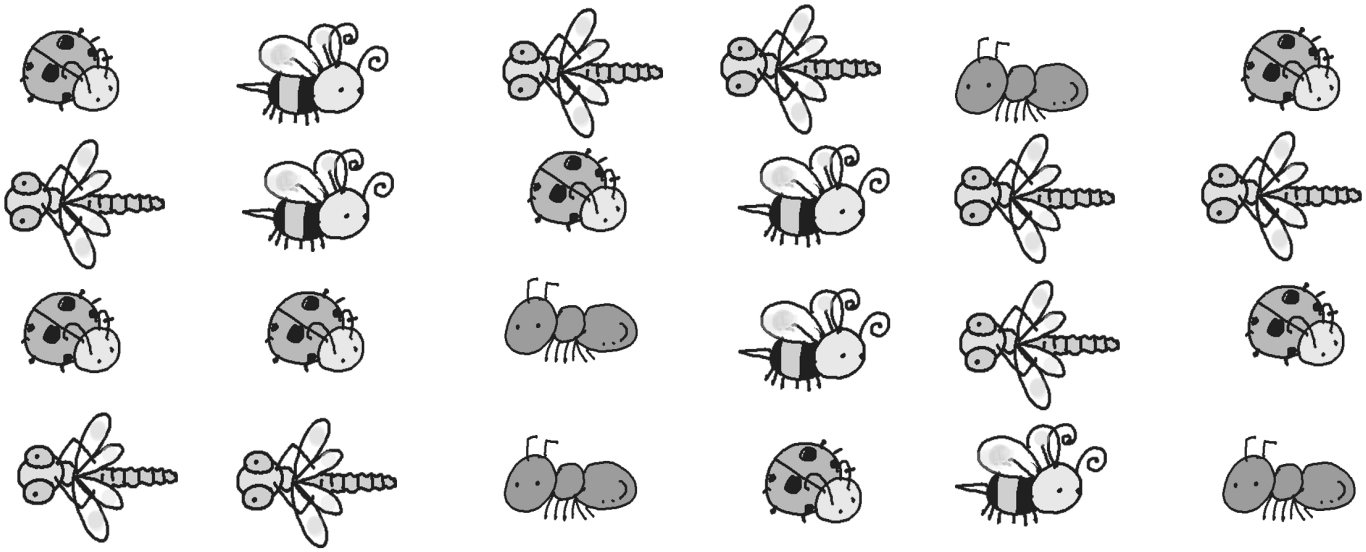

Example:

Number of ants 𝍸 |

Number of ladybugs ___

Number of bees ___

Number of dragonflies ___

Count the tally marks and put them as numbers in the table.

Kind of Bug	Ants	Ladybugs	Bees	Dragonflies
Number				

©edHelper

Name: _____

Complete the table below. Use the information in the table to complete the bar graph and answer the questions.

Company	Delivery Schedule Item	Day	Quantity	Cost	Total
The Barkery	dog & cat treats	Monday	200 treats	14¢ each	
Kitten Caboodle	canned cat food	Tuesday	115 cans	30¢ each	
Puppers' Pantry	dry dog food	Wednesday	5 bags	$24 each	
Squeaky Clean	laundry	Thursday	7 bags	$5 per bag	
Litter Mate	wood chip bedding	Thursday	15 bags	$4 each	
Fido's Feast	wet dog food	Thursday	40 cans	35¢ each	
Water Express	water	Friday	3 jugs	$3 each	

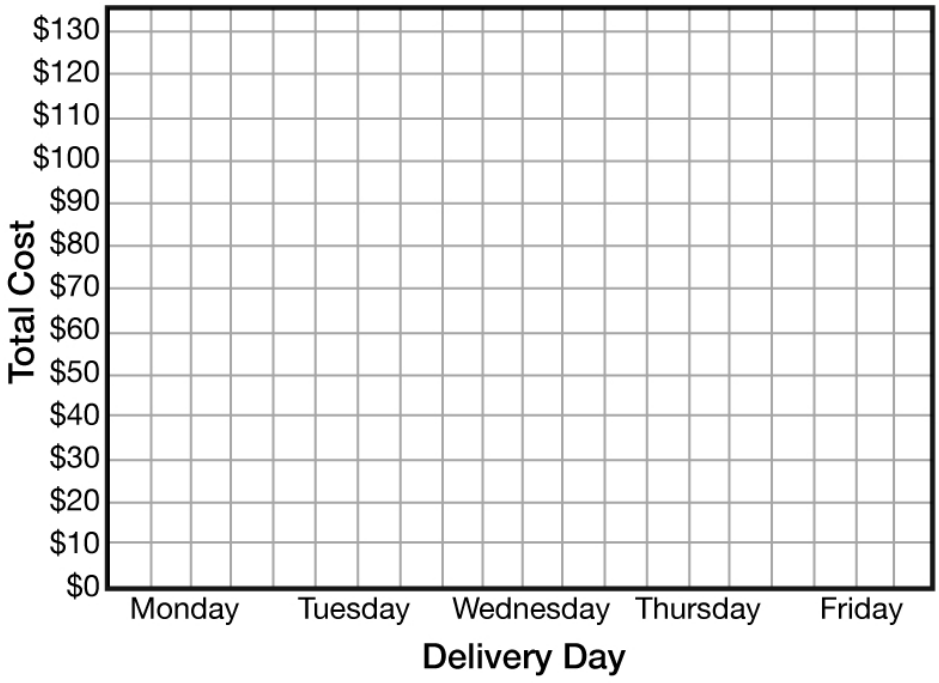

Which delivery day was the most expensive?

_____

Which delivery day was the cheapest?

_____

The Barkery delivery was twice as expensive as which other delivery?

_____

The Litter Mate delivery was half as expensive as which other delivery?

_____

Name: _____

Day of the Week	Number of Students
Monday	16
Tuesday	23
Wednesday	24
Thursday	19

This chart shows the number of students who went to play practice.

How many more students went to play practice on Monday than on Tuesday?

On which day did the greatest number of students miss going to play practice?

There was also play practice on Friday. Take a guess. How many students do you think will go to play practice on Friday. Why?

Cookies	Number Sold	Price per Cookie
sugar	12	$1
maple	6	$1
oatmeal	18	$2

Mary's class held a cookie sale.

How much did they make selling cookies?

What was the best selling cookie?

Cookies	Number Sold	Total Sales
oatmeal	15	$15
maple	14	$28
sugar	6	$6

Amy's class held a cookie sale.

If Jack bought one maple cookie and three sugar cookies, how much did he spend?

If it cost $6 to make the cookies, how much did they make from this bake sale?

Name: _____

This table shows the days and times of Ms. Mara's piano lessons next week.

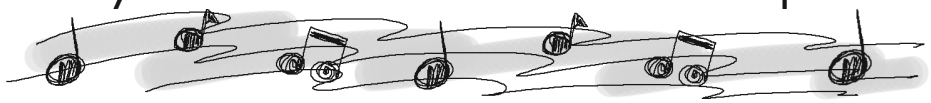

Time	Monday	Wednesday	Friday
9:00 - 9:30 a.m.	Randy	Addi	Shea
10:00 - 10:30 a.m.	Shea	Max	Landon
11:00 - 11:30 a.m.	Addi	Jenny	Randy
12:00 - 12:30 p.m.	Joe	Liam	Tyler

Circle True (T) or False (F)

PREVIEW

Join edHelper.com for full access.

3. Shea and Addi have lessons on Wednesday. T F

4. Tyler has the last lesson on Friday. T F

5. Jenny has the second lesson on Wednesday. T F

6. Ms. Mara teaches 4 students each of the days. T F

©edHelper

Name: _____

The sun is down, the people are asleep, and it's time for Gnorman the garden gnome to get to work. He has much to do before sunrise. On the table below is Gnorman's schedule. Answer the questions to help keep Gnorman on task.

Gnorman's Schedule

10:00 P.M. - 11:30 P.M.	weed garden
11:30 P.M. - 01:30 A.M.	cat patrol
01:30 A.M. - 02:00 A.M.	trash pick up
02:00 A.M. - 03:00 A.M.	tend mushroom patch
03:00 A.M. - 03:45 A.M.	shine fruit & veggies
03:45 A.M. - 04:30 A.M.	spread compost

What task will Gnorman spend the most amount of time doing?

_____

PREVIEW

Join edHelper.com for full access.

What is the most common amount of time Gnorman will spend doing a task?

_____

How much time will Gnorman spend spreading compost?

_____

Gnorman will spend twice as much time weeding the garden as what other tasks?

_____

_____

Gnorman will spend the same amount of time on cat patrol as what four other tasks combined?

_____

_____

_____

_____

How much total time will Gnorman spend doing all of the tasks on his schedule?

_____

Name: _____

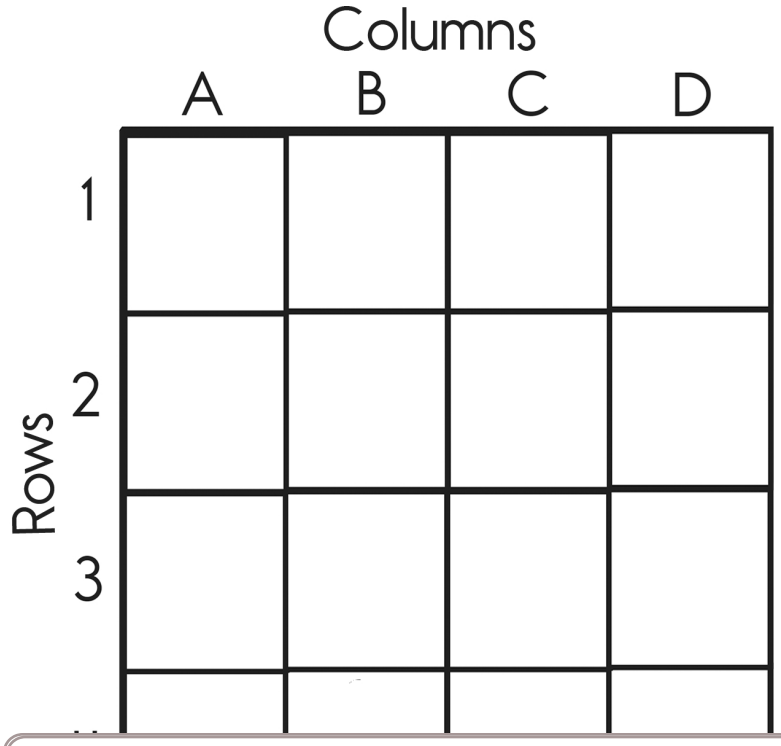

Write the numbers 1-10 in different boxes. Write their locations here.

1 : row ___, column ___
2 : row ___, column ___
3 : row ___, column ___
4: row ___, column ___
5 : row ___, column ___
6: row ___, column ___
7: row ___, column ___
8 : row ___, column ___

PREVIEW

Join edHelper.com for full access.

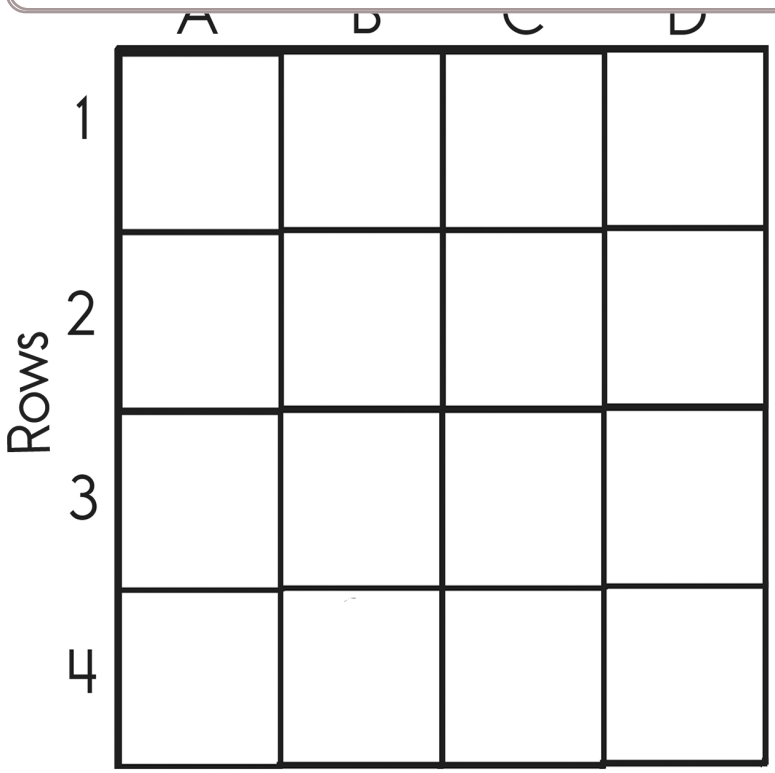

Write the letters a-j in different boxes. Write their locations here.

a: row ___, column ___
b: row ___, column ___
c: row ___, column ___
d: row ___, column ___
e : row ___, column ___
f : row ___, column ___
g: row ___, column ___
h: row ___, column ___
i: row ___, column ___
j: row ___, column ___

©edHelper

Name: _____

Jacob's favorite player is number 42 - 21. "What's your favorite player?" Jacob asks Kevin. "My favorite player's jersey has a number that is 3 less than your favorite player," Kevin replies.

What number is on the jersey of Jacob and Kevin's favorite players?

Mrs. Walker wrote the numbers 8 and 40 on the board. She always had a weird way to teach math. "Now, class," said Mrs. Walker. "My printer is broken. Please write your own

PREVIEW

Join edHelper.com for full access.

April is putting together goodie bags for her birthday party. She invited 9 friends, and everyone can come except for Sara. At the party store, she bought 23 stickers. She wants to give everyone (including herself) an equal number of stickers. How many should she put into each goodie bag?

Name: _____

PREVIEW

Join edHelper.com for full access.

What is the least common multiple of 4 and 2?	What is the greatest common factor of 2 and 12?	What is the least common multiple of 6 and 7?
Holly has 40 books. She organized them equally into 5 boxes. How many books in each box?	How many total legs are on 13 owls?	Round 526 to the nearest hundred.

Name: _____

This is Flavio the Afghan Hound. He **loves** going to Mutts n' More Pet Salon. His people only take him once his lovely locks reach a certain length, however. Use the time line below to answer Flavio's questions.

Flavio's Hair Length

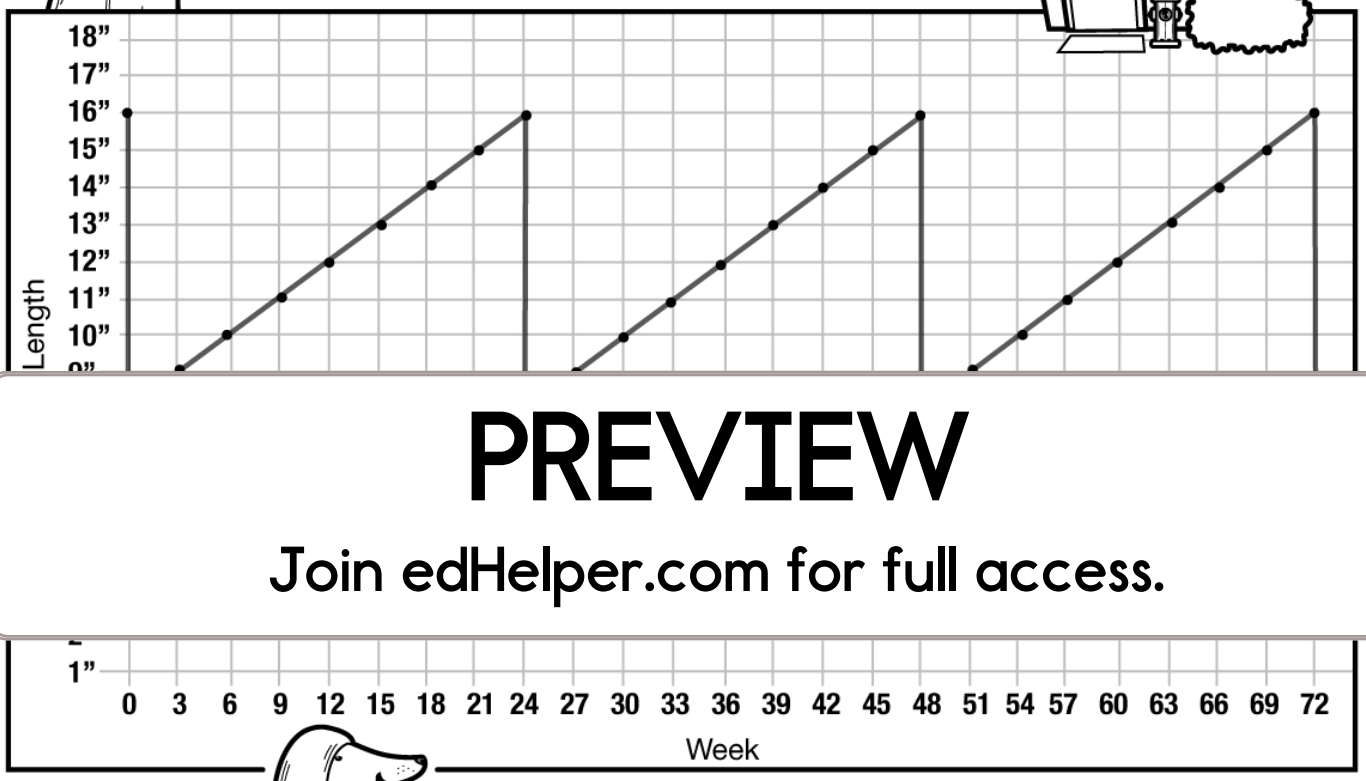

PREVIEW

Join edHelper.com for full access.

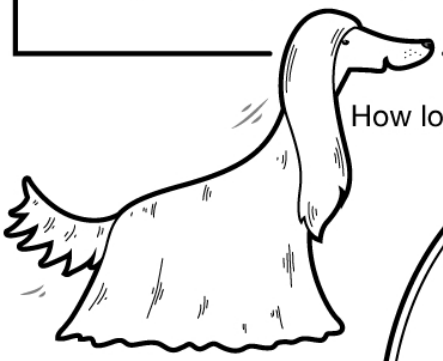

How long is my hair when I get to go to Mutts n' More for a haircut? _____

How long is my hair after I get a haircut? _____

How many weeks do I have between each haircut? _____

What is the ***average*** length of my hair? _____

Today is week 72. At what week will I get to get my next hair cut? _____



If at 48 weeks, Flavio waited an extra six weeks to get his haircut and got it cut an extra three inches, how would the graph change? In another color, graph the new line.

Sometimes when I go to Mutts n' More, I get a new, fancy updo. Draw a picture of what my next fancy updo should be.

Name: _____

Tess is selling 6 puppies. She has written their color and weight on these scraps of paper.

Name: Tank
Color: Brown
Weight: 27 lb.

Name: Tag
Color: Dk. Yellow
Weight: 29 lb.

Name: Tad
Color: Lt. Yellow
Weight: 27 lb.

Name: Tea
Color: Brown
Weight: 34 lb.

Name: Trista
Color: Brown
Weight: 27 lb.

Name: Tackle
Color: Black
Weight: 32 lb.

PREVIEW

Join edHelper.com for full access.

Lt. Yellow	
Brown	
Black	

29 lb.	
32 lb.	
34 lb.	

Write three things we can learn from these tables.

1. _____

2. _____

3. _____

©edHelper

Name: _____

These garden gnomes have been collecting coins for years. They often find them near the sidewalk in their yard. Until today they had no idea what they were for. The gnomes are very excited to learn that they can buy things with the coins, but they have some questions. Complete the table then answer their questions using the information.

Gnome	Pennies	Nickles	Dimes	Quarters	Total Money
Gnorma	𝍸 ||||		|||	𝍸 ||	
Peony	|	𝍸 |||	𝍸 ||	||	
Gnorman	𝍸 |	||	|	𝍸 ||	
Juniper	|||	|	𝍸 ||	𝍸 |||	
Sassafras	||	𝍸	||||	|||	
Chip	𝍸 ||	|||	||||	𝍸 ||	
Gnorbert	||||	𝍸 |	|||	|||	

PREVIEW

Join edHelper.com for full access.

Which gnome has collected the most money?

_____

Chip would like to know if he has enough money to buy a boat. The boat he wants costs $4599.00 If not, how much more money does Chip need?



_____

Juniper collected twice as much money as which other gnome?

_____

The gnomes would like to know if they ***pool*** all of their money together, could they buy a pool? The pool they want costs $18.99. If so, how much money would they have left over?

_____ _____

Peony has always wanted to try bubble gum. She wants to get enough for all of the gnomes to each have a piece. The bubble gum comes in packages of five. Each package costs 80¢. Can she buy enough bubble gum for every gnome to have a piece?

Name: _____

Draw an area model to solve 57 x 7.

Justin is taking a 24-hour walk challenge. He is trying to stay awake for 24 hours and plans to walk as far as he can. Each hour he plans to sit and rest for 5 minutes. If he is able to

PREVIEW

Join edHelper.com for full access.

Robot AQD said, "I have YYYY robot cats."

Robot EFG said, "I have YY robot cats."

Robot cat said, "Each Y stands for five cats. We have lots of cats!"

How many cats does Robot AQD have? How many cats does Robot EFG have?

Name: _____

Use the data to finish this line graph.

* Ben threw 145 feet

* Wren threw 120 feet

PREVIEW

Join edHelper.com for full access.

Draw these faces into the table and write their locations.

is at row ___ and column ___.

is at row ___ and column ___.

is at row ___ and column ___.

is at row ___ and column ___.

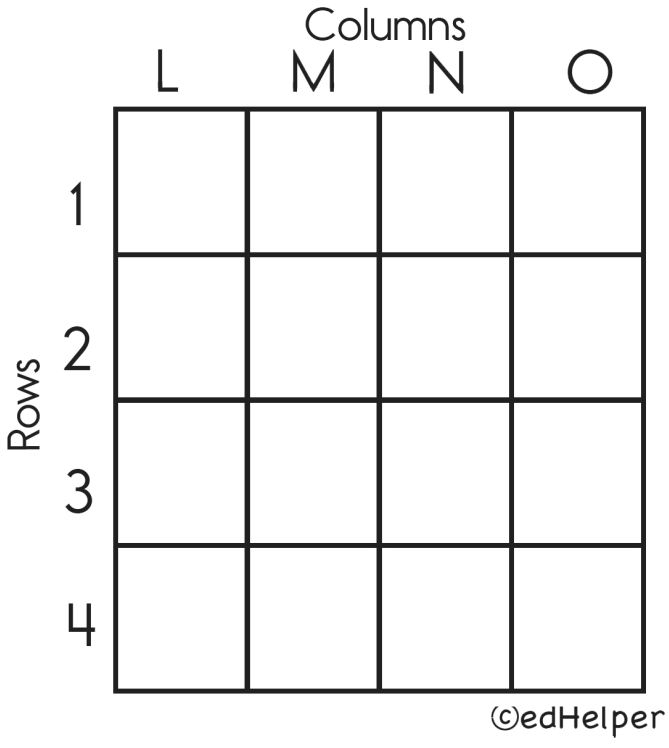

©edHelper

Name: _____

Jace is going to get a cat. He has used tally marks to record the times certain breeds are mentioned in his pet book.

Favorite Cat Breed

Persian	𝍸 𝍸 ||
Siamese	||||
Rag-doll	𝍸 ||
Bengal	𝍸 𝍸

Count and use numbers to make a table with this data.

Favorite Cat Breed

PREVIEW

Join edHelper.com for full access.

Kayla visited a super-sized pet store. She used tally marks to record the colors of parakeets she saw there.

Parakeet Colors

Green	𝍸 𝍸 𝍸
Purple	|||
Yellow	𝍸 ||||
Blue	𝍸 𝍸 ||||
Rainbow	||

Parakeet Colors

Using the data, list the colors of parakeets this store has from greatest to least.

_____

_____

_____

_____

©edHelper

Name: _____

Make a line graph that shows this temperature data.

Average Temperature
During July

Week 1 - 90
Week 2 - 85
Week 3 - 70
Week 4 - 90



Make a table that shows this temperature data.

PREVIEW

Join edHelper.com for full access.

Write and answer three questions using these.

1. _____

2. _____

3. _____

©edHelper

Name: _____

Circle any of the following that are NOT equal to 6,400.

64 x 1000
(6 x 1,000) + (4 x 100)
(4 x 1,000) + (6 x 100)
six hundred forty
6.400

PREVIEW

Join edHelper.com for full access.

14 x ___ + 10 = 136

Subscribe to Get Answer Keys

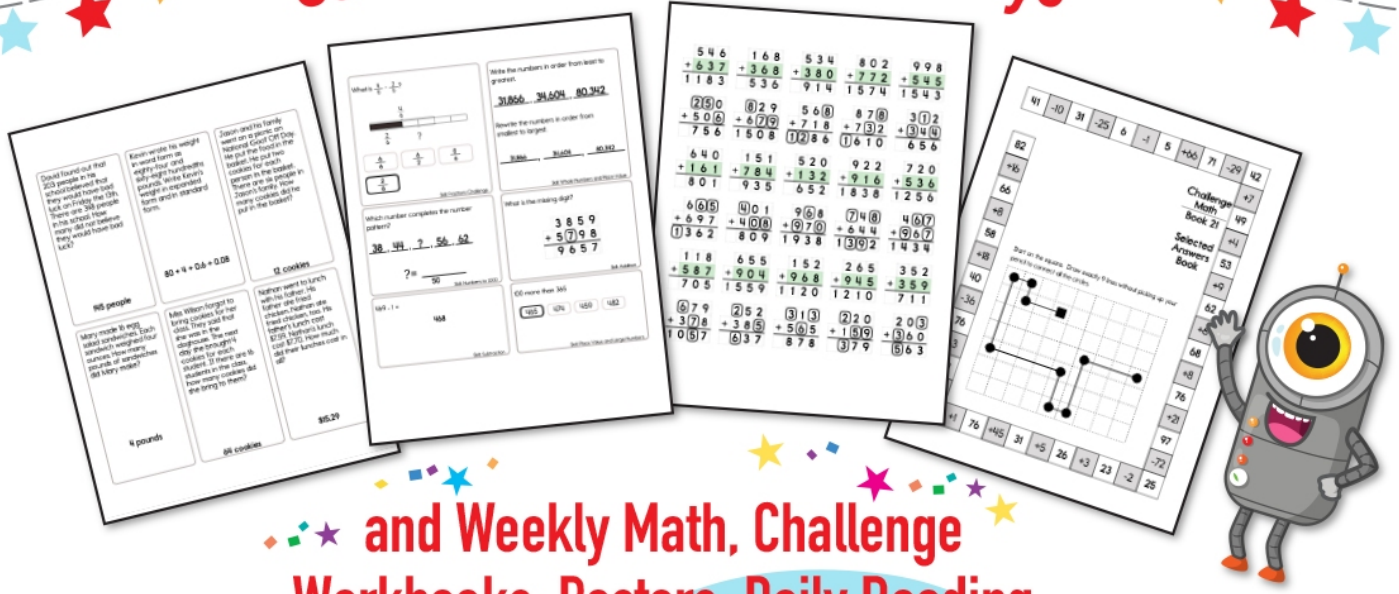

and Weekly Math, Challenge Workbooks, Posters, Daily Reading, and so much more!

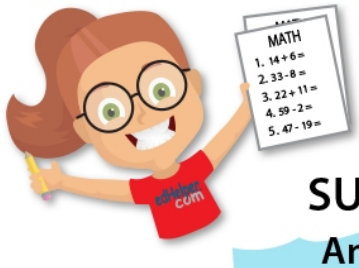

SUBSCRIBE TO RECEIVE EVEN MORE

Answer Keys • Effective Activities • Access to as many printables as you need!

edHelper.com

Where can I get more of this great stuff?
More math!
More spelling!
It's NO PREP at edHelper.
More history!
CLASS RULES
edHelper.com!
New online math games!
More things for the classroom!
More science!
New ideas!
More puzzles!

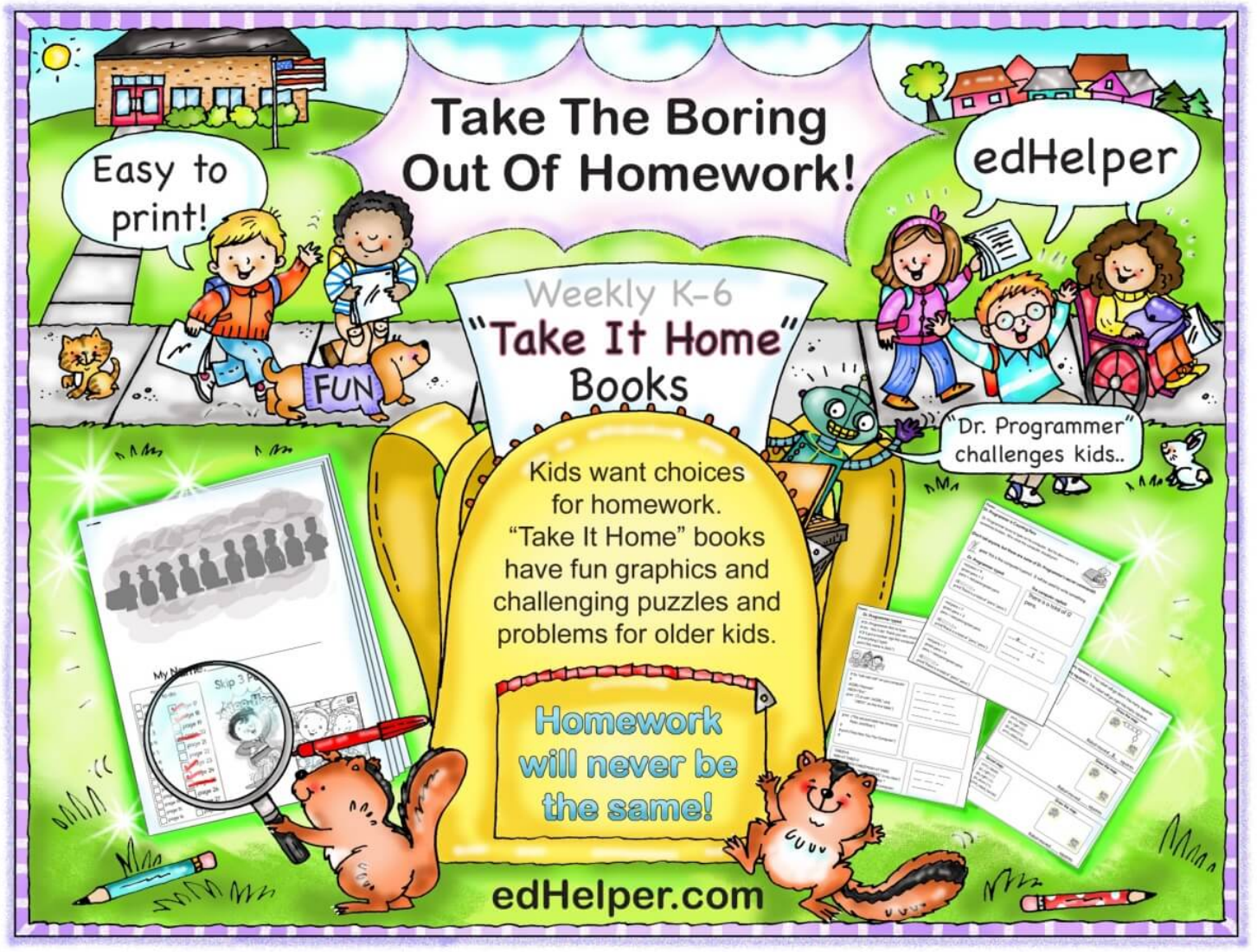
Take The Boring Out Of Homework!
Easy to print!
edHelper
Weekly K-6
"Take It Home" Books
FUN
"Dr. Programmer" challenges kids..
Kids want choices for homework. "Take It Home" books have fun graphics and challenging puzzles and problems for older kids.
Homework will never be the same!
edHelper.com

Name: _____

17 = _____ - 2
_____ = 25 - 13
10 = _____ - 8

Robert drew a rectangle that is 4 inches by 8 inches. He wants to arrange some crackers on top of his rectangle. The crackers are each 2 inches by 2 inches. How many crackers can he place onto his rectangle without overlapping them?

10 x 10	3 less than 843	5 x 5 + 5

Name: _____

Pumpkins are on sale for $2.27 per pound. Robert bought a 2-pound pumpkin. Nathan bought a 7-pound pumpkin. How much more did Nathan pay?

Emma likes to draw triangles, but isosceles triangles are her favorite.
"They are so cool," she explains. "They have two equal sides and two equal angles. After I draw the triangle, I write the angle that is the same. Can you guess the third angle?"
She drew a purple triangle and wrote 36°. She drew a green triangle and wrote 56°. She drew a blue triangle and wrote 41°. What is the third angle for each of her triangles?

Hannah is playing Half Court Quick Hoops at the local arcade. She may be playing way too much! She averages 8 baskets in just 6 seconds. If she can keep up at that rate, how many baskets will she get in during the first round, which is 66 seconds?